Logikrätsel

Welche der dargestellten Figuren sind Würfelnetze
und ergeben einen geschlossenen Würfel?

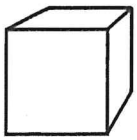

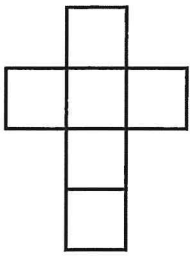

☐ richtig
☐ falsch

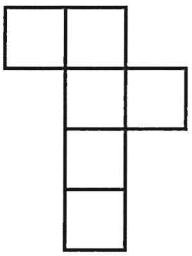

☐ richtig
☐ falsch

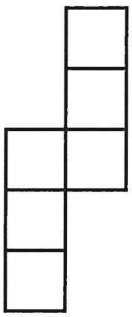

☐ richtig
☐ falsch

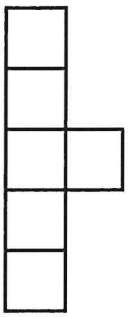

☐ richtig
☐ falsch



☐ richtig
☐ falsch

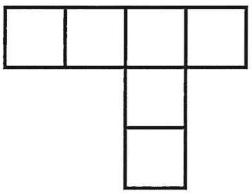

☐ richtig
☐ falsch

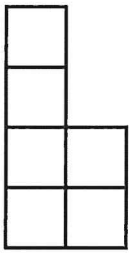

☐ richtig
☐ falsch

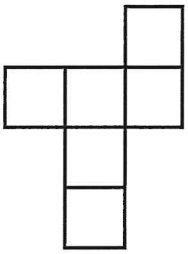

☐ richtig
☐ falsch



☐ richtig
☐ falsch

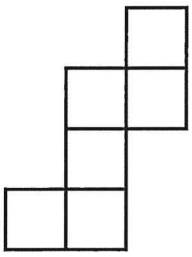

☐ richtig
☐ falsch

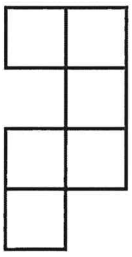

☐ richtig
☐ falsch

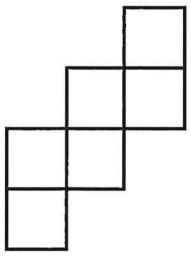

☐ richtig
☐ falsch

Lösung auf Seite 2

Lösung

Logikrätsel

Welche der dargestellten Figuren sind Würfelnetze
und ergeben einen geschlossenen Würfel?

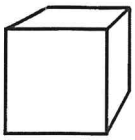

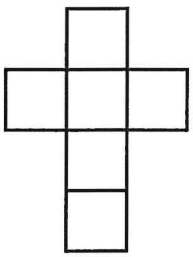

☒ richtig
☐ falsch

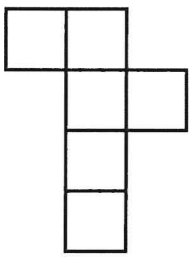

☒ richtig
☐ falsch

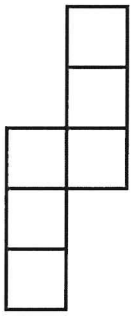

☒ richtig
☐ falsch

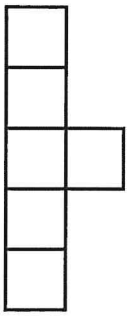

☐ richtig
☒ falsch

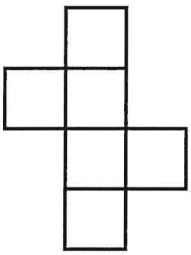

☒ richtig
☐ falsch

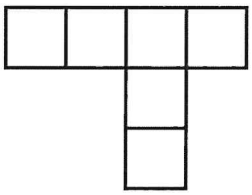

☐ richtig
☒ falsch

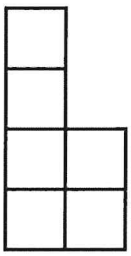

☐ richtig
☒ falsch



☒ richtig
☐ falsch



☒ richtig
☐ falsch

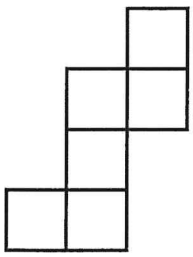

☒ richtig
☐ falsch

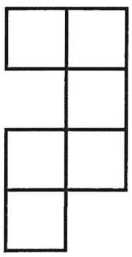

☐ richtig
☒ falsch



☒ richtig
☐ falsch

Um die einzelnen Würfelnetze selber überprüfen zu können, bietet es sich an, die entsprechenden Netzdarstellungen mit einer Schere auszuschneiden und anschließend zu Falten. Bei der richtigen Darstellung, sollte ein kleiner Würfel entstehen.

www.Raetseldino.de